Name _____ Date _____

Canadian Flag Search

Can you name three places where the Canadian flag flies in your community?

1._____

2._____

3._____

Points on a Maple Leaf

The maple leaf on the flag has points. Can you finish numbering the points and finish the sentence?

The maple leaf has _____ points.

Can you draw a happy face on the maple leaf and colour it?



© Rainbow Horizons Publishing Inc.

Z-36(A)

Ten Provinces and Three Territories

Canada has

Communities,

With 

and their stories;

Communities

In

provinces and

In

territories.

Start from the east

And go to the west,

To see why Canada is the best.



1.

© Rainbow Horizons Publishing Inc.

Z-36 (B)

Name _____ Date _____

Canada Search

Would you like to search the map of Canada? Can you find.....

the four provinces or territories that start with N ?

1. _____ 2. _____

3. _____ 4. _____

a province or territory that touches the Pacific Ocean?

_____

one province with Northwest Territories on top of it?

_____

the province that is an island?

_____

the province that has Canada's capital city, Ottawa?

_____

the province or territory that you live in?

_____

© Rainbow Horizons Publishing Inc.

Z-36(C)